Time: 10 Minutes **Paper Math 5** **Total Marks: 10**

5th Month, 3rd Week, 5th Day	**Syllabus: Unit 7: Review** Exercise. Q # (3, 4)

Q.No.1. Identify the adjacent angles: **(5)**

سوال نمبر1: ملحقہ زاویوں کی پہچان کریں:

(a)

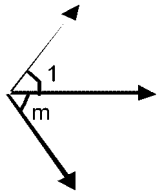

(b)

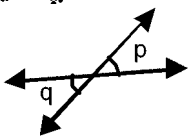

(c)

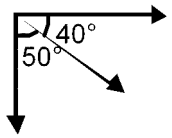

(d)

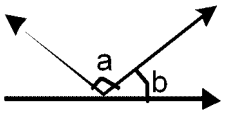

1

Time: 10 Minutes **Paper Math 5** **Total Marks: 10**

5th Month, 3rd Week, 5th Day	**Syllabus: Unit 7: Review** Exercise. Q # (3, 4)

Q.No.1. Identify the adjacent angles: **(5)**

سوال نمبر1: ملحقہ زاویوں کی پہچان کریں:

(a)

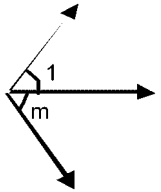

(b)

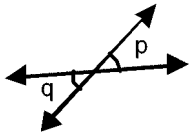

(c)

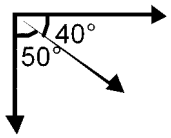
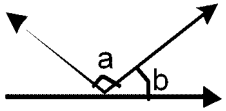
(d)